Winkelarten bestimmen

Spitz, recht, stumpf, gestreckt oder überstumpf?



Name: _____

Spitz unter 90°, recht genau 90°, stumpf zwischen 90° und 180°, gestreckt genau 180°, überstumpf über 180°. Trage Art und Gradzahl ein.

1

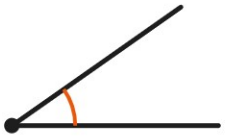

2

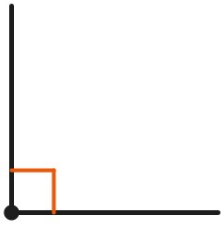

3

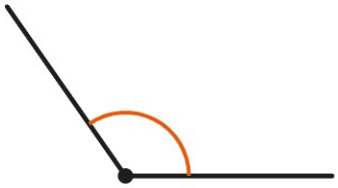

4



5

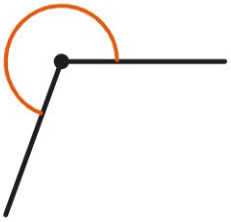

6

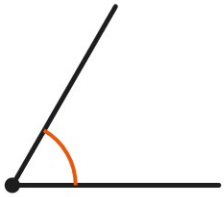

7



8

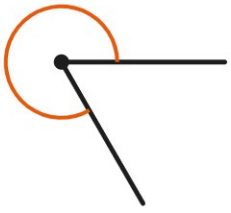

9

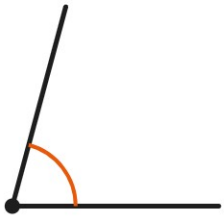

Tipp: Vergleiche zuerst mit der Ecke eines Blattes, die ist genau 90°.

Lösung: Winkelarten bestimmen



Spitz, recht, stumpf, gestreckt oder überstumpf?

Name: _____

Spitz unter 90°, recht genau 90°, stumpf zwischen 90° und 180°, gestreckt genau 180°, überstumpf über 180°. Trage Art und Gradzahl ein.

1

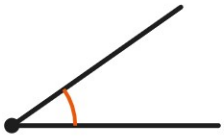

spitzer Winkel, 35°

2

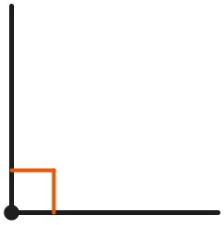

rechter Winkel, 90°

3

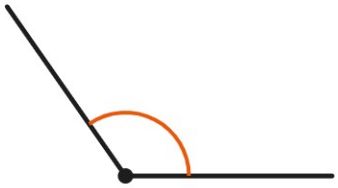

stumpfer Winkel, 125°

4



gestreckter Winkel, 180°

5

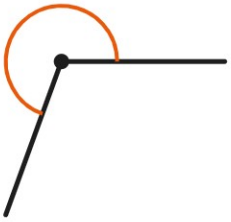

überstumpfer Winkel, 250°

6

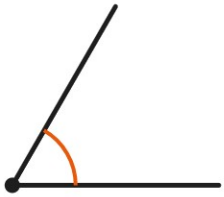

spitzer Winkel, 60°

7



stumpfer Winkel, 155°

8

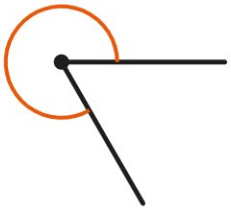

überstumpfer Winkel, 300°

9

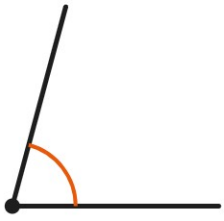

spitzer Winkel, 75°

Tipp: Vergleiche zuerst mit der Ecke eines Blattes, die ist genau 90°.